Adı: Soyadı:		1/G Çalışma Kağıdı		Tarih ...../...../2019

Aşağıdaki toplama işlemlerinde verilmeyen toplananlar kadar balon çizip işlemleri yapalım.



$$\begin{array}{r} 3 \\ +\ 3 \\ \hline 6 \end{array}$$

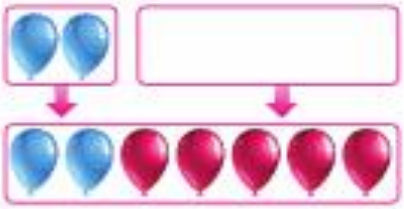

$$\begin{array}{r} 2 \\ +\ \ldots \\ \hline 7 \end{array}$$

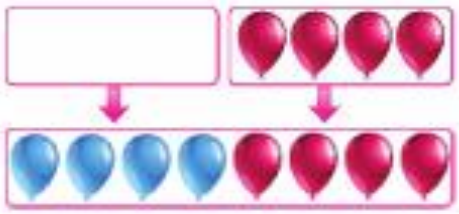

$$\begin{array}{r} \ldots \\ +\ 4 \\ \hline 8 \end{array}$$

$$\begin{array}{r} \ldots \\ +\ 1 \\ \hline 8 \end{array}$$



$$\begin{array}{r} 5 \\ +\ \ldots \\ \hline 9 \end{array}$$

Aşağıdaki toplama işlemlerinde verilmeyen toplananları örnekteki gibi bulalım.

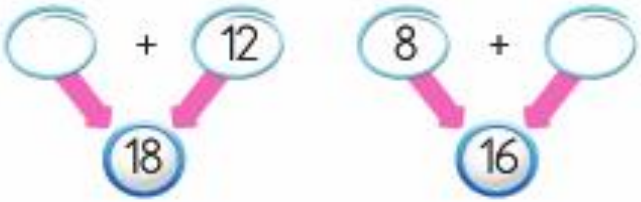

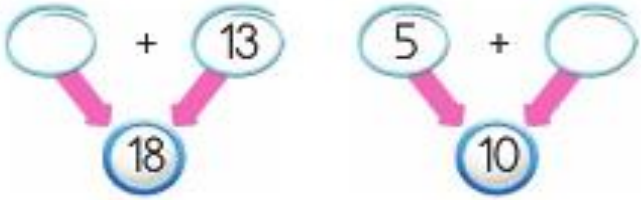

Aşağıdaki işlemlerde verilmeyen toplananları bulalım.

6 + □ = 12	□ + 0 = 16
□ + 7 = 15	12 + □ = 12
14 + □ = 18	17 + □ = 18
9 + □ = 20	□ + 7 = 14
□ + 8 = 16	□ + 9 = 18

12 + □ = 13	10 + □ = 15	18 + □ = 20
□ + 7 = 12	□ + 5 = 18	□ + 0 = 13
□ + 9 = 10	19 + □ = 19	□ + 8 = 13

Aşağıdaki toplama işlemlerinde verilmeyen toplananları yazalım.

□ + 3 = 10	8 + □ = 10
4 + □ = 10	6 + □ = 10
□ + 5 = 10	□ + 10 = 10
10 + □ = 10	1 + □ = 10
□ + 1 = 10	7 + □ = 10

10 + ■ = 10	8 + ■ = 10	5 + ■ = 10
■ + 4 = 10	■ + 7 = 10	■ + 1 = 10
■ + 0 = 10	2 + ■ = 10	■ + 6 = 10

Aytuna SERT
1/G Sınıfı Çalışmaları